8．平行線の証明①

1　$\ell \,/\!/\, m$ であることを証明しなさい。

①

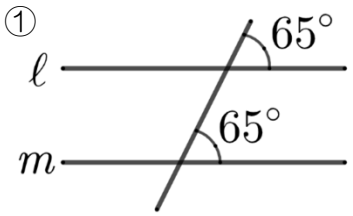

□ が等しいので $\ell \,/\!/\, m$

②

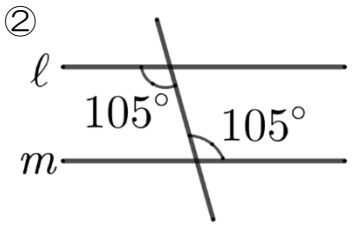

□ が等しいので $\ell \,/\!/\, m$

③

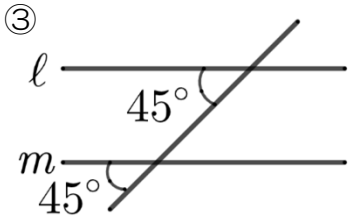

□ が等しいので $\ell \,/\!/\, m$

④

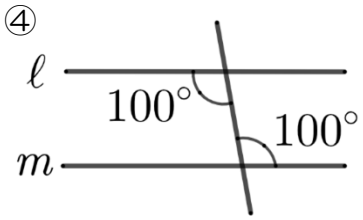

□ が等しいので $\ell \,/\!/\, m$

⑤

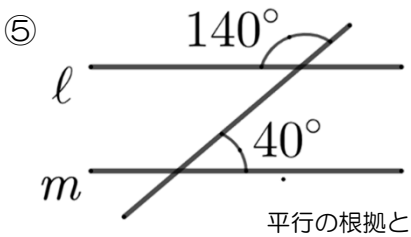

平行の根拠となる角を図示しよう

□ が等しいので $\ell \,/\!/\, m$

2　平行である２つの直線を選びなさい。

①

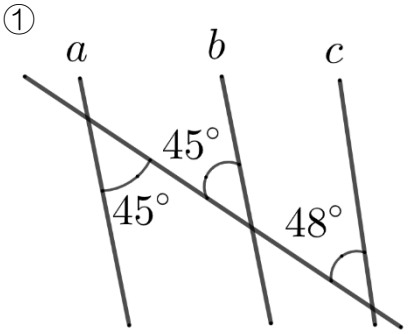

②

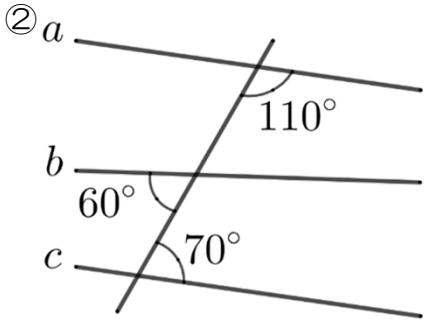

③

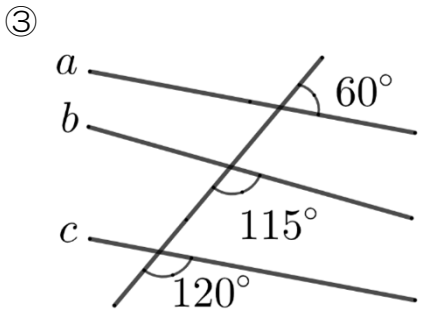
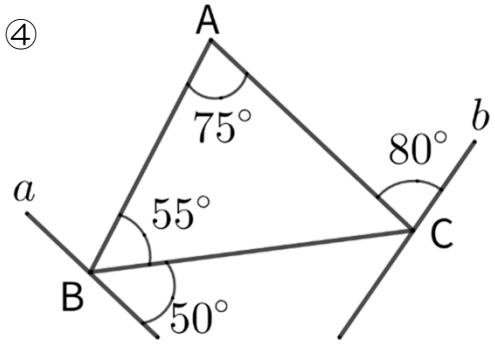
④